Introduction:

Practice: Households in rented and owned accommodation (Book 13 test 2)

The chart below shows the percentage of households in owned and rented accommodation in England and Wales between 1918 and 2011.

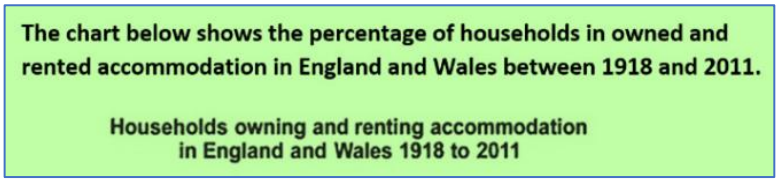

1. The chart illustrates what proportion of households lived in owned and ranted accommodation from 1918 to 2011 in England and Wales.

2. The diagram compares the proportion of households living in owned and rented accommodation in England and Wales from 1918 to 2011.✓

3. The chart compares the proportion of household~~e~~holds in owned and rented accommodation in England and Wales ~~between~~ from 1918 ~~and~~ to 2011.

4. The chart ~~below~~ gives information about the proportions of households in owned and ~~retend~~ rented in England and Wales ~~between~~ from 1918 ~~and~~ to 2011.

5. The diagram illustrates what proportion of households lived in owned and rented accommodation ~~by~~ in England and Wales from 1918 to 2011.

6. The bar chart illustrates ~~the accommodations owned and rented~~ changes in the percentage of households living in rented and owned accommodation in England and Whales from 1918 to 2011.

7. The bar chart illustrates the proportion of ~~houses~~ households that lived in owned or rented accommodation in England and ~~w~~Wales from 1918 to 2011.

Practice: Book 15 test 2

The graph below shows the number of tourists visiting a particular Caribbean island between 2010 and 2017.

Summarise the information by selecting and reporting the main features, and make comparisons where relevant.

1. The ~~figure~~ diagram illustrates how many tourists visited a ~~special~~ specific/certain Caribbean island from 2010 to 2017.
2. The line graph illustrates ~~the~~ changes in the number of tourists ~~visited~~ visiting a certain Caribbean island from 2010 to 2017.
3. The ~~figure~~ diagram illustrates changes in the quantity of tourists visiting a particular ~~c~~Caribbean island from 2010 to 2017.
4. The chart illustrates how many tourists visited a particular Caribbean island from 2010 to 2017.✓
5. The diagram illustrates how many tourists visited a particular Caribbean island from 2010 to 2017.✓
6. The diagram illustrates how many tourists visited a particular Caribbean island and compares where they stayed from 2010 to 2017.✓
7. The line graph illustrates how many tourists visited a particular island in the Caribbean from 2010 to 2017.

Example: Swiss birth & death rates (p.32)

The chart below gives information about birth and death rates in Switzerland from 1980 to 2030 according to United Nations statistics.

Summarise the information by selecting and reporting the main features, and make comparisons where relevant.

Write at least 150 words.

Switzerland birth and death rates 1980-2030

- The bar chart illustrates how many people were born and died in Switzerland between 1980 and 2020, along with predictions for 2030.
- The bar chart illustrates how the rate of birth and death changed in Switzerland between 1980 and 2020, along with predictions for 2030.

Practice: Urban population in Asian countries (Book 18 test 2)

The graph below gives information about the percentage of the population in four Asian countries living in cities from 1970 to 2020, with predictions for 2030 and 2040.

Summarise the information by selecting and reporting the main features, and make comparisons where relevant.

1. ~~t~~The line graph illustrates the proportion of people in four Asian countries who/that lived in cities ~~from~~ between 1970 ~~to~~ and 2020, along with projections for 2030 and 2040.

2. The diagram illustrates what proportion of the population have lived in cities in four Asian countries since 1970, along with predictions ~~for 2030 and~~ until 2040.

3. The diagram illustrates the proportion of the population in four Asian countries ~~,~~ who lived in cities between 1970 and 2020, along with predictions for 2030 and 2040.

4. The diagram illustrates the proportion of people living in ~~U~~urban areas in four Asian countries between 1970 and 2020, as well as predictions for 2030 and 2040.

5. The graph illustrates ~~how many~~ what proportion of people lived in cities ~~of~~ in four Asian countries between 1970 and 2020, as well as predictions for 2030 and 2040.

6. The chart illustrates what proportion of people lived in cities in four Asian countries between 1970 and 2020, along with predictions for 2030 and 2040.✓

7.The diagram illustrates how the percentage of the population who lived in four Asian countries has changed since 1970, along with predictions until 2040.

Overview:

Practice: Book 13 test 2

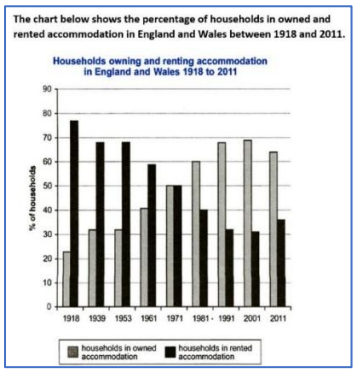

Analysis notes:

- *rented 1st initially -> overtaken by owned*
- *owned increase*
- *rented decrease*

The diagram illustrates what proportion of households lived in owned and rented accommodation in England and Wales from 1918 to 2011.

1. Overall, although the ~~second figure~~ latter initially ranked first, it was overtaken by the former ~~one towards the end~~later on. ~~The share of people living in a r~~Rented accommodation decreased significantly, while the other figure rose ~~rather considerably~~at a similar rate.

2. Overall, although ~~the proportion of households in~~ rented accommodation ranked first initially and declined significantly, ~~which~~ it was overtaken later on by ~~in~~ owned ~~accomodation latar on.with a considerable increase~~, which increased at a similar rate.

→ Overall although rented accommodation ranked first initially, it was overtaken by owned. The former declined significantly, while the latter increased at a similar rate.

3. Overall, although rented accommodation ranked first and decreased significantly, owned ~~accommodation~~ experienced an ~~dramatic~~ increase at a similar rate, overtaking it during the period.

4. Overall, although rented accommodation initially ranked first and decreased significantly during this period, it was overtaken later on by owned ~~accommodation later on ,~~ which experienced an increase at a similar rate.

5. Overall, although rented accommodation ranked first initially, it was overtaken by ~~rented~~ owned~~accommodation~~ later on. The former decreased significantly, while the latter rose at a similar rate.

6. Overall, although rented accommodation initially accounted for the largest share, it was overtaken by owned ~~accommodation~~ later on. The ~~figure for owned accommodation~~ latter increased significantly, while the ~~figure for rented accommodation~~ former experienced a ~~significant~~ decline at a similar rate.

7. Overall, rented accommodation accounted for the highest proportion initially, although it was overtaken by owned ~~accommodation towards the end~~later on. ~~The proportion of households in owned accommodation~~ The latter saw a dramatic increase, while the ~~figure for rented accommodation~~ former decreased at a similar rate.

Body:

The graph below shows the quantities of goods transported in the UK between 1974 and 2002 by four different modes of transport.

Summarise the information by selecting and reporting the main features, and make comparisons where relevant.

Write at least 150 words.

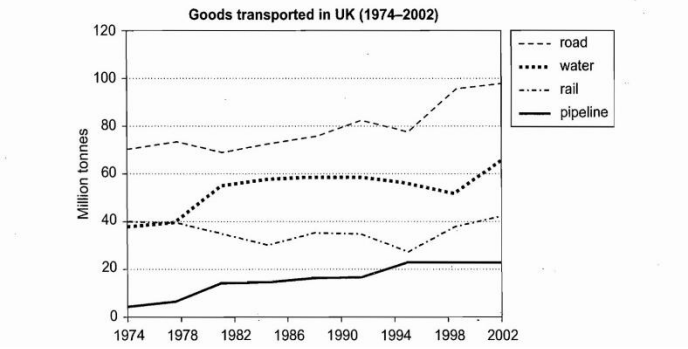

Notes:

- Road: 70m, fluc until 1982, gradual/moderate increase 81m, small drop, rise to almost 100m

- Pipeline: 5m, gradual increase until 1995 22m, stable

Example: Body paragraph 3

- The figure for pipeline stood at 5m in 1974 and increased gradually until 1995, after which it remained stable at 22m.

- The figure for pipeline started at 5m and increased gradually until 1995 before levelling off at 22m[and remaining stable for the rest of the period].